单项选择题

7. 函数$y=(3^x-3^{-x})\cos x$在区间$[-\frac{\pi}{2},\frac{\pi}{2}]$的图象大致为（　）

A.

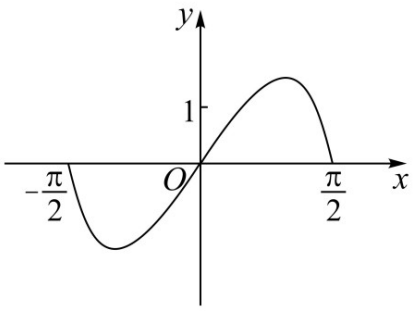

B.

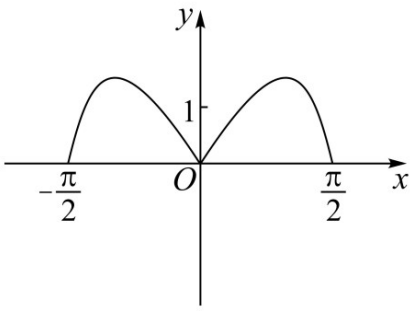

C.

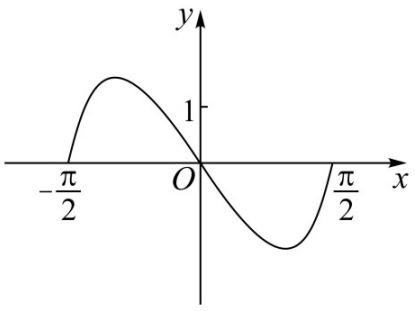

D.

